Polygone ou pas ?

Reconnaître un polygone

Un polygone est une figure FERMÉE dont tous les côtés sont des SEGMENTS (des traits droits).

1 **Coche la case des figures qui sont des polygones. Pour les autres, dis pourquoi à voix haute : pas fermée, ou un côté courbe ?**

A

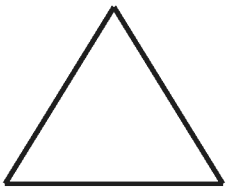

☐

B



☐

C

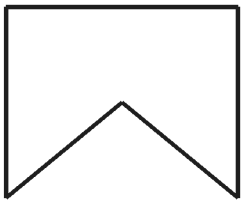

☐

D



☐

E

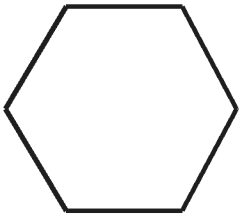

☐

F

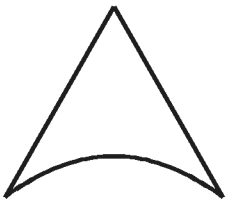

☐

G



☐

H

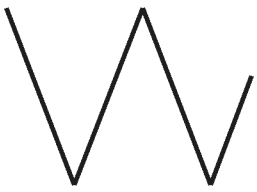

☐

I

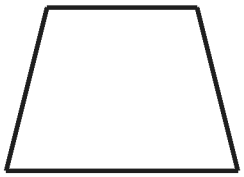

☐

J

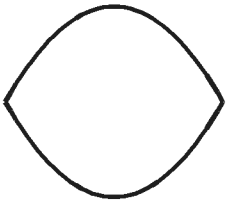

☐

K

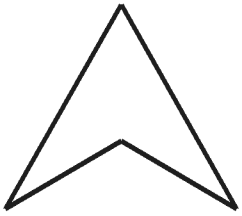

☐

L

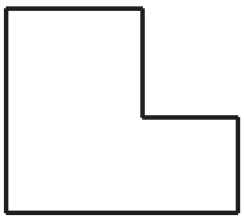

☐

Polygone ou pas ?

Corrigé · Reconnaître un polygone

Un polygone est une figure FERMÉE dont tous les côtés sont des SEGMENTS (des traits droits).

1 **Coche la case des figures qui sont des polygones. Pour les autres, dis pourquoi à voix haute : pas fermée, ou un côté courbe ?**

A

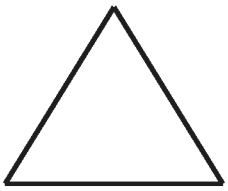

☑

B



pas fermée

☐

C

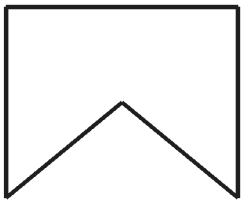

☑

D



côté courbe

☐

E

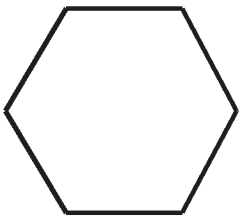

☑

F

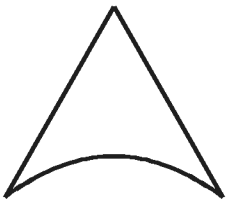

côté courbe

☐

G



☑

H

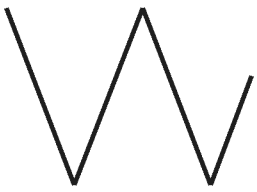

pas fermée

☐

I

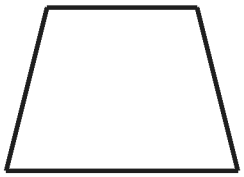

☑

J

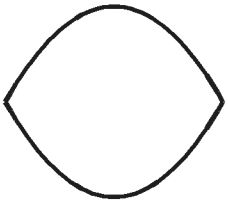

côté courbe

☐

K

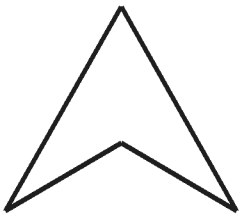

☑

L

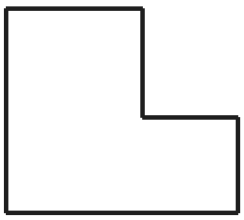

☑